Five and a Bit Ten-Frames Activity

How many dots are there on the ten-frame?
Can you describe this as 'five and a bit'?

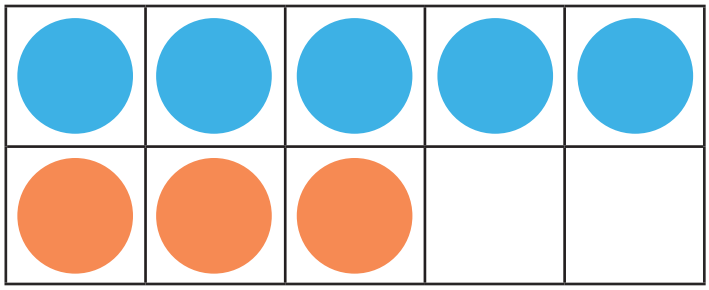

5 needs ☐ more to make 8

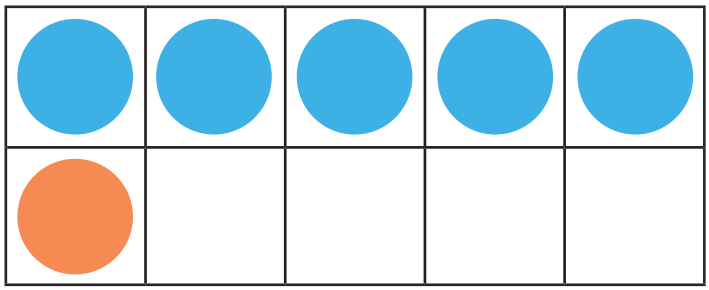

5 needs ☐ more to make 6

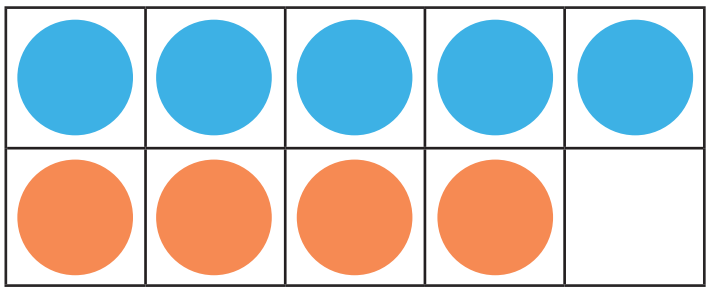

5 needs ☐ more to make ☐

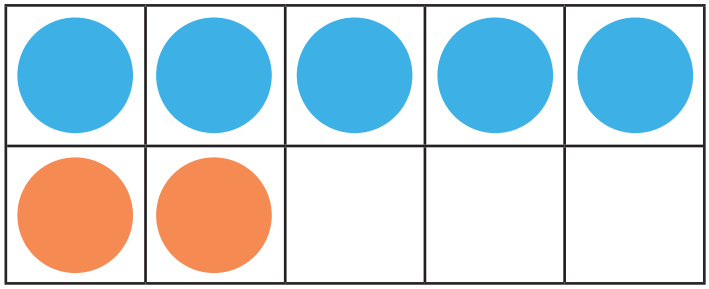

5 needs ☐ more to make ☐

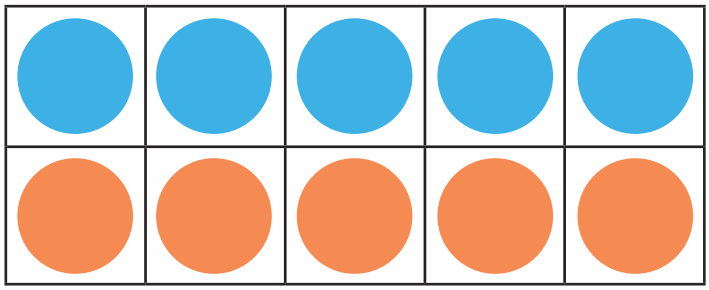

5 needs ☐ more to make ☐

visit twinkl.com

Five and a Bit Ten-Frames Activity

How many sea stars are there on the ten-frame?
Can you describe this as 'five and a bit'?

8 is 5 and ☐ more.



7 is 5 and ☐ more.



☐ is 5 and ☐ more.



☐ is 5 and ☐ more.

☐ is 5 and ☐ more.

visit twinkl.com